SSC CGL Exam Day Based Paper (12 Oct 2026)

Q1. Instructions: For the question below, carefully examine the Reference Statement. Then, identify the single option among the four alternatives (a, b, c, d) that is an EXACT AND COMPLETE REPLICATION of the Reference Statement. Pay exceptionally close attention to every character, number, symbol, space, and punctuation mark.
Reference: Amsterdam; 27 Apr.il, 2025 (Saturday).
(a) Amsterdam; 27 Apr.il, 2025 (Saturday).
(b) Amsterdam; 27 April, 2025 (Saturday).
(c) Amsterdam; 27 Apr.il, 2025 (Sunday).
(d) Amsterdam; 27 Ap.ril, 2025 (Saturday).
Ans.(a)

Q2. In a certain coded language 'AMINES' is coded as 'OAJEIW' and 'MERITS' is coded as 'OPENAI'. How will 'JANGLE' be coded in the same code language?
(a) CIBJVD
(b) ZHEJYD
(c) AHCJWF
(d) BJBHXE
Ans.(c)

Q3. Four of the following five figures are similar in some way and thus form a group. Which figure is different from the group?

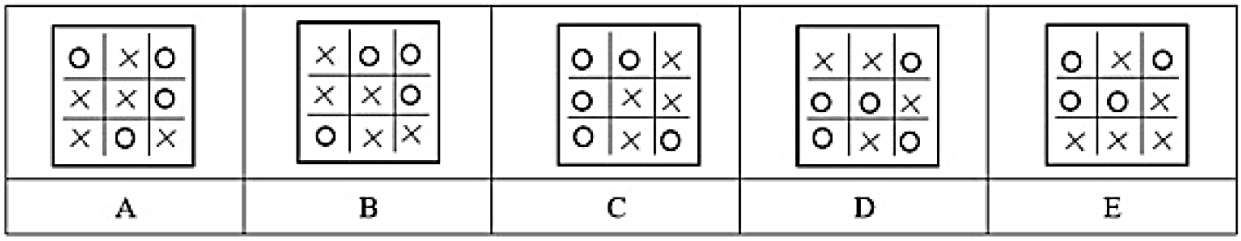

(a) D
(b) A
(c) E
(d) B
Ans.(b)

Q4. In a certain coding system, the word 'REMOTE' is represented as 'KYSPGS' and 'BRAND' is represented as 'IRDTC'. Using the same pattern, how would the word 'MOBILE' be encoded?
(a) FMJCPN
(b) KQMEQN
(c) DKHANL
(d) DMHCNN
Ans.(b)

Q5. In the following question, select the number which can be placed at the sign of question mark (?) from the given alternatives.

3	5	6	90
2	4	5	40
4	7	?	140

(a) 3
(b) 4
(c) 5
(d) 10
Ans.(c)

Q6. A staff member travels 180 km in 3 hours. What is his speed?
(a) 50 km/h
(b) 55 km/h
(c) 60 km/h
(d) 65 km/h
Ans.(c)

Q7. In this type of questions, question is provided with some issues/disputes/problem, followed by few methods to resolve the problem in statement choosing the appropriate problem solving method that can be implemented.
A city has traffic jams due to poorly timed signals. Immediate practical step?
(a) Charge tolls for entering congested areas
(b) Ban vehicles during daytime
(c) Build new roads immediately
(d) Synchronize signals based on peak patterns
Ans.(d)

Q8. Find the next number in the series: 19, 28, 40, 55, ?
(a) 71
(b) 74
(c) 73
(d) 77
Ans.(c)

Q9. Some conditional data is provided to you in form of statement you have to check which of the following statement are logically inference from given statement.
Statement: A psychological study reports: "Participants who received positive feedback showed increased cortisol levels, elevated heart rate, and decreased performance on subsequent tasks, contrary to our hypothesis."
The researchers noted that the feedback was given publicly in front of peers.

What complex inference can you draw?
(a) Positive feedback is always harmful to performance
(b) The public nature of the praise created performance anxiety that outweighed its benefits
(c) The study's methodology was flawed
(d) Participants were lying about their emotional responses
Ans.(b)

Q10. Instructions: Carefully examine the Reference Statement. Then, identify the single option among the four alternatives (a, b, c, d) that is an EXACT AND COMPLETE REPLICATION of the Reference Statement. Pay exceptionally close attention to every character, number, symbol, space, and punctuation mark.
Reference: Paris: July 14th, 1789.
(a) Paris: July 14.th, 1789.
(b) Paris: July 14th, 1789.
(c) Paris: July 14th, 1798.
(d) Pariss: July 14th, 1789.
Ans.(b)

Q11. Find out the alternative which will replace the question mark.
10/8 : 15/3 :: 12/10 : ?
(a) 14/5
(b) 17/5
(c) 9/5
(d) 21/5
Ans.(b)

Q12. Read the following statement carefully and identify the inference that follows.
Statement: A study shows that people who regularly eat breakfast tend to have lower rates of obesity and other health problems.
Inference:
I. Skipping breakfast causes obesity and other health problems.
II. Eating breakfast regularly can prevent obesity and other health problems.
III. People who are obese should stop eating breakfast.
(a) If only I follows
(b) If only II follows
(c) If both I and II follow
(d) If both II and III follow
Ans.(b)

Q13. A person returns a lost wallet containing cash but takes a ₹100 note. What is the most logical judgement?
(a) They are a thief
(b) They are honest
(c) They showed partial honesty
(d) They deserve a reward
Ans.(c)

Q14. A sum of ₹12,000 is invested at 6% per annum simple interest for 2 years. What will be the total amount after 2 years?
(a) ₹13,440
(b) ₹13,600
(c) ₹13,200
(d) ₹13,800
Ans.(a)

Q15. Following the death of a woman trekker in the forest of city , the Forest Department has stepped up vigil to control tress-passing into forest areas. The Forest Department has begun posting staff at the check-post at the entry of the forest. The check-post will be manned from dawn to dusk. The reasoning in the Forest Department's decision to be very vigilant about people tress passing into the forest is most vulnerable to criticism on the grounds that this decision
(a) Presumes that animals will not attack trekkers who have sought permission from the forest department before starting the trek.
(b) Presumes that the people who go through check post can take care of themselves from wild animals.
(c) Will help bring more awareness about the forest and wild animals of city X.
(d) Presumes that everyone entering the forest enters through the check-post .
Ans.(a)

Q16. In the following questions some issues are provided to you. you have to mark the appropriate answer logically that can be taken in such circumstances.
A teammate panics during a presentation. What would be the most emotionally intelligent way to respond?
(a) Avoid talking to them
(b) Force advice on them
(c) Dismiss their feelings
(d) Offer to listen without pushing
Ans.(d)

Q17. Which of these Rows/ Columns are related to each other in the same way?

Row	I	II	III	IV	V
1	6	12	36	72	54
2	5	10	20	40	60
3	8	16	32	64	72
4	9	18	36	72	81
5	11	22	44	88	99

(a) Row 1, 2, 3
(b) Row 1, 4, 5
(c) Row 2, 3, 4
(d) Row 3, 4, 5

Ans.(d)

Q18. Instructions: For the question below, carefully examine the Reference Statement. Then, identify the single option among the four alternatives (a, b, c, d) that is an EXACT AND COMPLETE REPLICATION of the Reference Statement. Pay exceptionally close attention to every character, number, symbol, space, and punctuation mark.
Reference: Accra (GH): Mar 6, 1957.
(a) Accra (GH): Mar 6, 1957.
(b) Accr_a (GH): Mar 6, 1957.
(c) Accra (GH): Mar. 6, 1957.
(d) Accra (GH): Mar 6, 1975.
Ans.(a)

Q19. Read the following statement carefully and identify the inference that follows. Statement: The government has announced a new tax on sugary drinks.
Inference:
I. The government is trying to reduce the consumption of sugary drinks.
II. The tax will generate revenue for the government.
III. The tax on sugary drinks will be the only tax imposed by the government.
(a) If only I follows
(b) If only II follows
(c) If both I and II follow
(d) If both II and III follow
Ans.(c)

Q20. Which of the following pairs of numbers and signs, when their positions are interchanged, will correctly solve the given mathematical equation?
$228 \div 12 \times 14 + 38 - 57 = 129$
(a) 14 and 38, × and ÷
(b) 57 and 38, + and ÷
(c) 12 and 38, + and –
(d) 12 and 38, × and ÷
Ans.(c)

Q21. You witness a new student being isolated and mocked by a small group of popular students. What's your ethical decision?
(a) Ignore it to avoid becoming a target yourself.
(b) Join the popular group to fit in.
(c) Discreetly approach the new student and offer support, or report the bullying to a trusted adult.
(d) Publicly confront the popular group, risking escalation.
Ans.(c)

Q22. You hear conflicting stories from two friends in an argument. What is the most rational way to make a fair judgement?
(a) Support the one you've known longer
(b) Go with your gut feeling
(c) Compare both sides and verify facts
(d) Avoid giving judgement at all
Ans.(c)

Q23. There are eight members in a family - A, B, C, D, E, F, G and H. D is the wife of E. B and C are brother of D. H is the granddaughter of D. A is the mother of C. F, the only Child of E is married to G. F has no siblings. How is C related to F?
(a) Brother
(b) Uncle
(c) Father
(d) Nephew
Ans.(b)

Q24. Which of these Rows/ Columns are related to each other in the same way?

Row	I	II	III	IV	V
1	4	9	19	39	79
2	5	15	45	135	405
3	6	12	24	48	96
4	7	14	28	56	112
5	8	16	32	64	128

(a) Row 1, 2, 3
(b) Row 2, 3, 4
(c) Row 3, 4, 5
(d) Row 1, 4, 5
Ans.(c)

Q25. Select the option that shows the same relationship as between the first pair of words.
RUG : SVI :: MAT :?
(a) PDW
(b) NCW
(c) PCX
(d) NBV
Ans.(d)

Q26. What was the aim of the reduction of customs duties in 1991?
(a) Protecting domestic industries
(b) Increasing revenue only
(c) Promoting exports and integration with the global market
(d) Encouraging import substitution
Ans.(c)

Q27. The district of Shivamogga that is famous for its Iron-Ore and Manganese mineral is located in which state of India?
(a) Karnataka
(b) Maharashtra
(c) Rajasthan
(d) Jharkhand
Ans.(a)

Q28. Which of the following vocal forms is characterized by its emphasis on the intricate development of a single raga, often with a slow, elaborate alaap followed by compositions set to complex talas?
(a) Thumri
(b) Dhrupad
(c) Tappa
(d) Khayal
Ans.(d)

Q29. What significant milestone did ISRO achieve with the SpaDeX mission?
(a) First human spaceflight mission
(b) First space mission to Mars
(c) Successful demonstration of space docking capabilities
(d) First lunar landing mission
Ans.(c)

Q30. Which of the following waterways of India is navigable by mechanical boats up to Patnaand by ordinary boats up to Haridwar?
(a) National Waterway 4 (NW 4)
(b) National Waterway 2 (NW 2)
(c) National Waterway 1 (NW 1)
(d) National Waterway 3 (NW 3)
Ans.(c)

Q31. Who has been appointed as the Chairperson of the Central Board of Secondary Education (CBSE)?
(a) Rahul Singh
(b) Lokhande Prashant Sitaram
(c) Varun Bhardwaj
(d) Himanshu Gupta

Ans.(b)

Q32. Which of the following statements about scoring and penalties in field hockey is/are correct? 1) A field goal is valid only if played from inside the shooting circle. 2) In a penalty corner, the ball must exit and re-enter the circle before a goal. 3) A penalty stroke may be lifted to any height if pushed or flicked.
(a) Only 1 and 2 are Correct
(b) Only 2 and 3 are Correct
(c) Only 1 and 3 are correct
(d) 1, 2 and 3 are Correct
Ans.(d)

Q33. Which Indian traditional sport involves "raiders" touching opponents and returning to their half?
(a) Archery
(b) Hockey
(c) Kabaddi
(d) Golf
Ans.(c)

Q34. Which of the following statements is correct with regard to Consumer Price Index?
(a) It measures the average change in the sale price of goods and services either as they leave the place of production or as they enter the place of production.
(b) It is used to monitor changes in the cost of living over time.
(c) It is used to monitor the cost of the goods and services bought by producers and firms.
(d) It reflects the price of all the goods and services produced domestically.
Ans.(b)

Q35. Which Article directs the State to provide just and humane conditions of work and maternity relief?
(a) Article 39
(b) Article 41
(c) Article 42
(d) Article 47
Ans.(c)

Q36. "Appellate jurisdiction of the Supreme Court in appeals from High Courts in regard to civil matters" is provided in which of the following provisions of the Constitution of India?
(a) Article 133
(b) Article 132
(c) Article 131
(d) Article 134
Ans.(a)

Q37. Which of the following National Waterways (NW) is associated with the Udyogamandal and the Champakkara canals?
(a) NW-10
(b) NW-3
(c) NW-5

(d) NW-25
Ans.(b)

Q38. What does the area under a velocity-time graph represent?
(a) Acceleration
(b) Displacement
(c) Speed
(d) Impulse
Ans.(b)

Q39. What is the primary purpose of Article 262 of the Indian Constitution?
(a) To empower Parliament to provide for the adjudication of inter-State river water disputes
(b) To authorize the President to impose President's Rule in States
(c) To establish the Inter-State Council for policy coordination
(d) To regulate trade and commerce within the territory of India
Ans.(a)

Q40. The Avanti Mahajanapada was divided into two regions. What were the capitals of these regions?
(a) Ujjain and Vidisha
(b) Rajagriha and Pataliputra
(c) Shravasti and Kaushambi
(d) Kausambi and Varanasi
Ans.(a)

Q41. Consider the following statements regarding the Asian Games:
1. The first Asian Games were held in 1951 in New Delhi.
2. The Asian Games are also known as the Asiad.
3. A total of 15 countries participated in the first Asian Games held in 1951.
Which of the statements given above are correct?
(a) 1 and 2 only
(b) 2 and 3 only
(c) 1 and 3 only
(d) 1, 2 and 3
Ans.(a)

Q42. Which of the following dance forms and accompaniments is accurately matched?
(a) Rouf - Rabab and Tumbaknari
(b) Thiruvathira Kali - Dhol and Harmonium
(c) Saila - Pheran and Flute
(d) Sattriya- Nagara and tribal flute
Ans.(a)

Q43. The Minimum Needs Programme was introduced in India in the ____ year of the Fifth Five-Year Plan.
(a) second
(b) fourth
(c) first
(d) third
Ans.(c)

Q44. What is the "net gain" of ATP molecules produced during glycolysis?
(a) 4 ATP
(b) 36 ATP
(c) 2 ATP
(d) 38 ATP
Ans.(c)

Q45. "Proba-3 Mission", which will be launched aboard ISRO's PSLV, is associated with which space agency ?
(a) ESA (European Space Agency)
(b) CNSA (The China National Space Administration)
(c) NASA (The National Aeronautics and Space Administration)
(d) JAXA (Japan Aerospace Exploration Agency)
Ans.(a)

Q46. What is deducted from the gross investment to get the net investment?
(a) direct tax
(b) indirect tax
(c) profit
(d) depreciation
Ans.(d)

Q47. Which of the following pairs is correctly matched with regard to the subject and its respective list under the Seventh Schedule?
(a) Police - Union List
(b) Education - State List
(c) Trade and Commerce - Concurrent List
(d) Banking - State List
Ans.(c)

Q48. Which of the following characteristics best distinguishes Kamsale from other devotional dance forms in Karnataka, particularly in terms of its musical instrumentation, religious significance, and performance context?
(a) It is a temple dance performed silently by women, emphasizing stillness and subtle hand gestures to invoke goddess Durg
(b) It involves rhythmic clashing of metal cymbals called 'Kamsale by male performers, who sing praises of Lord Male Mahadeshwara, combining martial dance movements with devotional fervor during pilgrimage and festival rituals.
(c) It is a purely theatrical folk drama without any musical instruments, narrating mythological stories through dialogue and facial expressions.

(d) It is a harvest dance performed during the festival of Sankranti, primarily focused on celebrating agricultural prosperity with group formations and colorful costumes.
Ans.(b)

Q49. The longitudinal valley lying between lesser Himalaya and the Shivaliks are known as
(a) Purvanchals
(b) Duns
(c) Kullus
(d) Pir Panjal Range
Ans.(b)

Q50. Who among the following is one of the founders of the Kirana Gharana?
(a) Ustad Ali Baksh
(b) Ustad Inayat Khan
(c) Abdul Karim Khan
(d) Haji Sujan Khan
Ans.(c)

Q51. The base of a right prism is a triangle with sides 9 cm, 12 cm, and 15 cm. If the height of the prism is 10 cm, find the volume of the prism.
(a) 350 cm^3
(b) 760 cm^3
(c) 230 cm^3
(d) 540 cm^3
Ans.(d)

Q52. A vessel contained a certain amount of milk and water. When 20 litres of water were added to it, the new mixture was 40% milk. When 10 litres of milk were further added, the new mixture was 50% milk. The ratio of milk and water in the original mixture was:
(a) 3 : 2
(b) 2 : 1
(c) 2 : 3
(d) 3 : 4
Ans.(b)

Q53. Given that $27^{0.48} = x, 27^{0.86} = y$and $x^z = y^{10}$, then the value of z is close to:
(a) 18.65
(b) 17.02
(c) 20.86
(d) 17.92
Ans.(d)

Q54. If triangle ABC is a right angled isosceles triangle, right angled at B, then find the value of $\frac{\sin(A-C)+\sin(A+C)-2\sin B}{\cot A+\cot B+\cot C}$

(a) $\frac{1}{2}$

(b) $-\frac{1}{2}$

(c) $\frac{3}{2}$

(d) 0

Ans.(b)

Q55. A manufacturing plant employs 3,000 workers with varying hourly wages. The distribution of their wages is given below

Wage Range (₹ per hour)	Number of Workers
Less than 3.00	150
3.01-4.50	580
4.51-6.00	900
6.01-7.50	500
7.51-9.00	600
More than 9.00	270
Total	3,000

Using the data above, determine the median hourly wage of the employees (Round off your answer to two decimal places.)

(a) ₹6.23

(b) ₹4.74

(c) ₹5.98

(d) ₹5.79

Ans.(d)

Q56. An object is shaped like an ice cream cone, consisting of a hemisphere placed on top of a cone with an identical base radius. The volume of the hemispherical part is 144π cm^3, and the height of the conical part is 8 cm. What is the total surface area of the object?

(a) 132 π cm^2

(b) 108 π cm^2

(c) 60 π cm^2

(d) 168 π cm^2

Ans.(a)

Q57. In a circle of radius 17 cm, two chords are drawn at distances 8 cm and 15 cm from the center. Find the difference between the lengths of the two chords.

(a) 14 cm

(b) 16 cm

(c) 18 cm

(d) 20 cm
Ans.(a)

Q58. The value of $\sin^2\theta + \cos^2\theta - (\sec^2\theta - \tan^2\theta) + \tan\theta\cos\theta - \sin\theta$ is
(a) 0
(b) 4 sin θ cos θ
(c) -1
(d) $\sec^2\theta$
Ans.(a)

Q59. In a right - angled triangle ABC, right -angled at B, if tan A = $\frac{1}{\sqrt{3}}$, the value of (sin A cos C + cos A sin C) is:
(a) 1
(b) $\frac{3}{4}$
(c) $\frac{1}{2}$
(d) $\frac{1}{4}$
Ans.(a)

Q60. A sum of ₹1,000 is invested for 2 years at 10% per annum compound interest, compounded annually. Find the compound interest earned at the end of 2 years (in ₹).
(a) 210
(b) 230
(c) 200
(d) 220
Ans.(a)

Q61. What is the value of (2x + 7y), if mean of the following distribution is 53?

Class	0-20	20-40	40-60	60-80	80-100	Total
Frequency	7	11	x	8	y	60

(a) 137
(b) 127
(c) 133
(d) 151
Ans.(c)

Q62. The surface area of a sphere is numerically equal to the volume of another sphere. If the radius of the first sphere is 7 cm, find the radius (in cm) of the second sphere.
(a) $\sqrt[3]{174}$
(b) $\sqrt[3]{147}$
(c) $\sqrt{147}$
(d) $\sqrt{174}$

Ans.(b)

Q63. In the given figure, AB∥EF, ED∥CB and ∠BPD is 42°. What is the measure of ∠CQF?

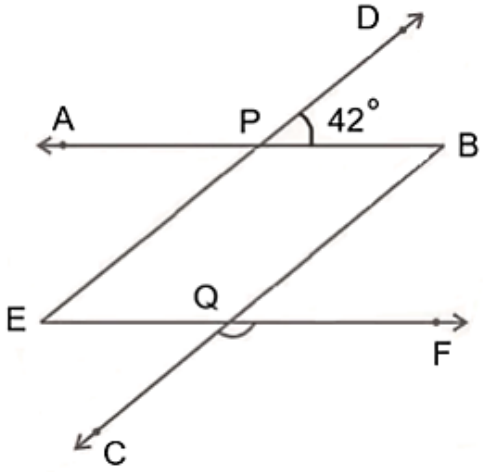

(a) 42^0
(b) 142^0
(c) 138^0
(d) 38^0
Ans.(c)

Q64. Yuvraj deposited a certain sum of money at 20% rate of interest per annum, compounded annually. At the end of 2 years, Yuvraj received a total amount of ₹34,668. What was the sum of money deposited by Yuvraj?
(a) ₹23,790
(b) ₹24,075
(c) ₹23,641
(d) ₹23,925
Ans.(b)

Q65. If a right triangle is right angled at A and AC = 6, BC = 10, find the value of tan B × tan C.
(a) 1
(b) 4/5
(c) 3/5
(d) 1/2
Ans.(a)

Q66. In a town, 75% of the registered voters cast their votes in an election contested by candidates X and Y. Candidate X won the election by 840 votes. If candidate Y had received 50% more votes, the election would have resulted in a tie. Find the total number of registered voters in the town.
(a) 5230
(b) 5600
(c) 5700
(d) 4800

Ans.(b)

Q67. In a right-angled triangle XYZ, with a right angle at Y, W is the mid-point of side YZ. XY = $8\sqrt{3}$ cm and XZ = 16 cm. Find the length of XW.
(a) $\sqrt{5}$ cm
(b) $2\sqrt{3}$ cm
(c) $4\sqrt{13}$ cm
(d) $\sqrt{9}$ cm
Ans.(c)

Q68. The distance between two cities A and B is 120 km. A motorcycle rider starts from A towards B at 8 am at a speed of 21 km/h. Another motorcyclist starts from B towards A at 9 am at a speed of 34 km/h. At what time (in 12-hour clock format) will they cross each other?
(a) 10:48 am
(b) 10:15 am
(c) 11:10 am
(d) 11:20 am
Ans.(a)

Q69. A juice manufacturer has a 60-litre tank containing apple juice and water in the ratio 3 : 1. To produce a lighter beverage, the quality control team wants to replace some of the existing mixture with pure water so that the final ratio of apple juice to water becomes 1 : 1. How many litres of the original mixture should be replaced with pure water?
(a) 20 litres
(b) 25 litres
(c) 18 litres
(d) 15 litres
Ans.(a)

Q70. If x : (y + z) = 3 : 8, y : (x + z) = 4 : 11, and x + y + z = 4950, then find the value of z - y.
(a) 720
(b) 1080
(c) 840
(d) 960
Ans.(d)

Q71. ₹ 265 is divided into A,B and C such that B gets ₹ 30 and the ratio of the amounts B and C get is 2:5.
A. Ratio of the amounts of A and B is 16 : 3
B. Ratio of the amounts of A and C is 32 : 15
C. Total amount of A and C is ₹235
D. Ratio of the amounts of (C+A) and (B+C) is 40 : 21
Choose the correct answer from the options given below.
(a) A, B, C only
(b) B, C, D only
(c) D, A, B only
(d) C, D, A only

Ans.(a)

Q72. The following table shows the number of seats reserved in different classes in a train on five different days. The capacity of each class is given in the bracket.

Day	2nd Class Non-AC (900)	1 Class Non-AC (500)	III Tier AC (500)	II Tier AC (250)	I Tier AC (150)
Monday	750	410	390	240	145
Tuesday	820	400	450	230	120
Wednesday	730	360	480	220	130
Thursday	640	480	490	190	122
Friday	700	490	495	210	140

What is the ratio of the number of vacant seats in AC classes on Monday to the number of reservations in non-AC classes on Friday?
(a) 238 : 17
(b) 25 : 238
(c) 343 : 9
(d) 9 : 343
Ans.(b)

Q73. Arvind bought an article for ₹x. He sold it to Biru at a loss of 19%. Biru spent ₹166 on its transportation and sold it to Minu at a profit of 35%. If Minu bought it for ₹1,755, then what is the value of x?
(a) 1,450
(b) 1,350
(c) 1,400
(d) 1,500
Ans.(c)

Q74. Two pie charts show the percentage-wise distribution of total sales of four products in the years 2023 and 2024. The total sales in 2023 were ₹8 lakh and in 2024 were ₹10 lakh. By how much (in ₹) did the sales of laptops increase from 2023 to 2024?

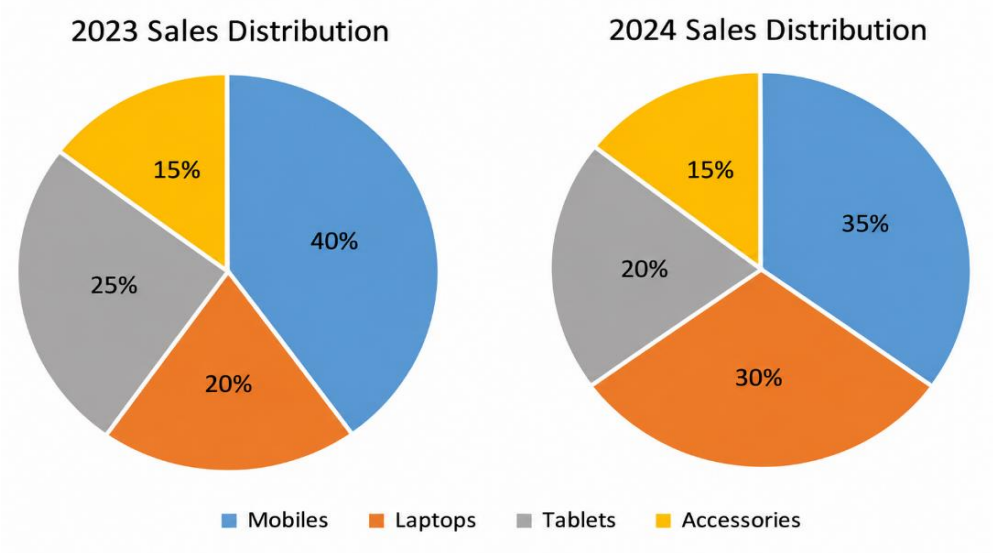

(a) ₹0.5 lakh
(b) ₹1.5 lakh

(c) ₹1 lakh
(d) ₹1.4 lakh
Ans.(d)

Q75. Pipe A can fill a tank in 6 hours, pipe B can fill the same tank in 36 hours and pipe C can fill the same tank in 18 hours. The time taken (in hours) by them to fill one-fourth of the same tank if they operate together is:
(a) 2
(b) 1
(c) 3
(d) 4
Ans.(b)

Q76. Given below are six sentences taken from a paragraph. The first and the last sentences are numbered S1 and S2 and are placed in the first and last positions respectively and are fixed in their positions. The other four sentences between the first and last sentences are jumbled up and are numbered A, B, C, and D. Rearrange the jumbled sentences in a logical sequence keeping the unity and coherence of the paragraph intact. Choose the correct alternative that best describes the sequence.
S1 Then, one day, she was up, playing; Isabel was in the kitchen fixing lunch for the two boys when they'd come in from school, and she heard Grace fall down in the living room.
A. And she ran to the living room and there was little Grace on the floor, all twisted up, and the reason she hadn't screamed was that she couldn't get her breath.
B. When you have a lot of children you don't always start running when one of them falls, unless they start screaming or something.
C. Yet, Isabel says that when she heard that thump and then that silence, something happened in her to make her afraid.
D. And, this time, Grace was quiet.
S2 And when she did scream, it was the worst sound, Isabel says, that she'd ever heard in all her life, and she still hears it sometimes in her dreams.
(a) ADBC
(b) DCBA
(c) BDCA
(d) DCAB
Ans.(c)

Q77. Given below are four jumbled sentences. Select the option that gives their correct order to form a meaningful and coherent paragraph.
A. Scientists warn that urgent action is needed to reduce greenhouse gas emissions.
B. Governments and organizations are investing in renewable energy and sustainable practices.
C. Rising global temperatures have led to extreme weather events worldwide.
D. Without these measures, climate change could have catastrophic consequences for ecosystems and humans.
(a) D – B – A – C
(b) B – A – D – C
(c) A – D – B – C
(d) C – A – B – D
Ans.(d)

Q78. Which word is nearest in meaning to "endeavoured"?
"Framton Nuttel endeavoured to say the correct something which should duly flatter the niece."
(a) Avoided
(b) Attempted
(c) Refused
(d) Ignored
Ans.(b)

Directions (79-83): Read the passage and answer the following questions. The contemporary information economy has generated a paradox that its most enthusiastic proponents rarely acknowledge: the unprecedented circulation of information has not necessarily produced a commensurate expansion of public understanding. Digital infrastructures have dismantled many traditional barriers to knowledge, yet they have also accelerated the dissemination of conjecture, manufactured consensus and ideologically convenient half-truths. The resulting epistemic environment is characterised less by an absolute scarcity of information than by an increasingly formidable difficulty in distinguishing substantiated knowledge from its counterfeit.
This apparent abundance can be (1) ____: an information ecosystem saturated with competing assertions may remain profoundly deficient in independently verified understanding. Claims frequently acquire legitimacy through repetition rather than evidentiary corroboration, while the original provenance of an assertion becomes obscured as it passes through successive layers of commentary, appropriation and retransmission. Consequently, the distinction between primary evidence and derivative interpretation grows increasingly indistinct.
The problem is compounded by institutional incentives that privilege immediacy over deliberation. News organisations competing for dwindling attention, political actors pursuing strategic advantage and digital platforms optimising engagement may all contribute, albeit for different reasons, to an environment in which the velocity of dissemination supersedes the rigour of verification. Within such an environment, provisional conjectures can (2) ____ into seemingly incontrovertible orthodoxies, particularly when they reinforce pre-existing ideological commitments. Contradictory evidence, meanwhile, is frequently dismissed as partisan interference rather than evaluated on its merits.
A further complication arises when the burden of intellectual scrutiny is (3) ____ from those advancing a claim to those questioning it. Instead of requiring proponents to substantiate their assertions, public discourse increasingly demands that sceptics disprove them. This inversion creates fertile conditions for obfuscation, enabling rhetorically sophisticated but evidentially impoverished arguments to survive sustained criticism.
The remedy is not an indiscriminate rejection of digital communication, nor a nostalgic restoration of unquestioned institutional authority. Rather, it requires a renewed commitment to evidentiary transparency, intellectual humility and the institutional protection of dissent. A mature information culture must recognise that the circulation of an assertion is not equivalent to its verification, just as the appearance of consensus cannot substitute for the independent examination of evidence. Without these distinctions, societies risk mistaking informational abundance for epistemic progress.

Q79. Fill in the blank 1.
(a) inchoate
(b) illusory
(c) intransigent
(d) invidious

Ans.(b)

Q80. Fill in the blank 2.
(a) attenuate
(b) vacillate
(c) ossify
(d) ameliorate
Ans.(c)

Q81. Fill in the blank 3.
(a) exonerated
(b) obviated
(c) circumscribed
(d) displaced
Ans.(d)

Q82. Select the most appropriate meaning of the highlighted word "provenance" as used in the passage.
(a) The degree to which a statement corresponds with objective reality.
(b) The historical origin or source from which something is derived.
(c) The predominance of one interpretation over competing explanations.
(d) The process through which an argument is rendered logically indefensible.
Ans.(b)

Q83. Select the most appropriate meaning of the highlighted word "obfuscation" as used in the passage.
(a) The deliberate act of making something unclear, confusing or difficult to understand.
(b) The act of establishing the authenticity of a disputed assertion through independent evidence.
(c) The formal withdrawal of an accusation after sufficient evidence establishes innocence.
(d) The unwillingness to abandon a rigid opinion despite compelling contradictory evidence.
Ans.(a)

Q84. Arrange the following sentences in the correct order to form a logically sound and coherent paragraph.
The parts are:
A. joke and endeavoured to smile appropriately, though
B. to say shock, remained detectable in my expression.
C. I suspect some residue of my bewilderment, not
D. Then I realized he was making some sort of
(a) DCBA
(b) DBCA
(c) DABC
(d) DACB
Ans.(d)

Q85. A part of the following sentence is highlighted. Choose the option that can replace the highlighted part to improve the sentence. If you feel Options A, B, or C do not improve the sentence, then choose Option D: "No improvement required."
The cunning minister is a master at the art of running with the hounds and hunting with the hare.
(a) dancing with the hare and hunting with the hounds
(b) dining with the hare and running with the hounds
(c) running with the hare and hunting with the hounds
(d) No improvement required
Ans.(c)

Q86. Choose the option that is the most appropriate conversion of the following sentence into Direct Speech.
He exclaimed with regret that he had forgotten his wallet at home.
(a) He exclaimed, "Hey! I had forgotten my wallet at home.
(b) He said, "Oh no! I have forgotten my wallet at home."
(c) He exclaimed, "Ah! I have forgot my wallet at home."
(d) He said, "I regret I have forgotten my wallet at home."
Ans.(b)

Q87. Choose the option that is the most appropriate conversion of the following sentence into Direct Speech.
She told the detective that she had been sleeping when the thieves had broken in.
(a) She said to the detective, "I had slept when the thieves had broken in."
(b) She said to the detective, "I had slept when the thieves has broken in."
(c) She told the detective, "I had been sleeping when the thieves broke in."
(d) She told the detective, "I had been asleep when the thieves were breaking in."
Ans.(c)

Q88. Directions: Identify the part containing a GRAMMATICAL ERROR.
The professor insisted / that each student submits / the dissertation / before the stipulated deadline.
(a) The professor insisted
(b) that each student submits
(c) the dissertation
(d) before the stipulated deadline
Ans.(b)

Q89. Find the part of the given sentence that has an error in it. If there is no error, choose 'No error'.
Each of the student must bring their own lunch.
(a) Each of the student
(b) No error
(c) must bring
(d) their own lunch.
Ans.(a)

Q90. Which of the following idioms given in the alternatives has the meaning?
The most noticeable problem, or the loudest complaint, is the one that receives attention and is addressed first.
(a) Stew in one's own grease
(b) Grease the skids
(c) The squeaky wheel gets the grease
(d) Grease the wheels
Ans.(c)

Q91. Choose the correct option to fill in the blanks.
The days seemed endless and ____ nights were even longer. We travelled through ____ incredibly beautiful landscape and came to one of ____ largest lakes, Nam Tso.
(a) the, an, the
(b) the, a, a
(c) a, an, the
(d) the a, an
Ans.(a)

Q92. Given below are four jumbled parts of a sentence. Select the option that gives their correct order and forms a meaningful sentence.
A. is a quiet and ideal place
B. sunny weekends
C. the neighbourhood park
D. for a picnic on
(a) CBDA
(b) DCAB
(c) CADB
(d) ACDB
Ans.(c)

Q93. Change the following sentence into the Active form.
The new theory is said to have been developed over decades.
(a) They say that researchers have developed the new theory over decades.
(b) They say that the new theory was developed over decades.
(c) Someone is said to have developed the new theory over decades.
(d) The new theory developed over decades.
Ans.(a)

Q94. The following sentence is divided into four parts given in the alternatives A, B, C, and D. Select the alternative which contains that part of the sentence which has an error.
She mentioned that the annual cultural programme gives place in the open-air theatre every monsoon season without fail.
(a) She mentioned that the annual
(b) cultural programme gives place
(c) in the open-air theatre every
(d) monsoon season without fail.
Ans.(b)

Q95. Select the option that expresses the given sentence in active voice.
It is said that the manuscript was smuggled out of the country.
(a) People say that someone smuggled the manuscript out of the country.
(b) People say that the manuscript smuggled out of the country.
(c) People said that someone had smuggled the manuscript out of the country.
(d) Someone says the manuscript to be smuggled out of the country.
Ans.(a)

Q96. From the alternatives given below, select the correct passive voice of the following sentence.
The cheetah chased the wild boar with lightning speed.
(a) The wild boar has been chased with lightning speed by the cheetah.
(b) The wild boar was chased with lightning speed by the cheetah.
(c) The wild boar had been chased with lightning speed by the cheetah.
(d) The wild boar was being chased with lightning speed by the cheetah.
Ans.(b)

Q97. Rearrange the following sentence parts to form a meaningful and grammatically correct paragraph:
P. He crafted his thoughts into a careful message, his fingers flying across the keys.
Q He swiftly entered a lengthy string of characters and numbers that was the recipient's email address.
R. A simple subject line summarizes the entire point of the message.
S. He breathed a last sigh of relief as he hit the send button and saw the email disappear.
(a) Q, R, P, S
(b) P, Q, S, R
(c) S, Q, P, R
(d) Q, S, R, P
Ans.(a)

Q98. Select the option that expresses the given sentence in reported speech.
Rohit said, "Are you not being hasty in taking the decision to give up your job? If I were you I would think carefully before quitting."
(a) Rohit said to me if I was not being hasty in taking the decision to give up my job. He further says that if he were in my place he will have thought carefully before quitting.
(b) Rohit asked me not to be hasty in taking the decision to give up my job. He also remarked that if I were in your place I would have thought carefully before quitting.
(c) Rohit asked me if I was not being hasty in taking the decision to give up my job. He further remarked that if he were in my place he would have thought carefully before quitting.
(d) Rohit questions me if I was not being hasty in taking the decision to give up my job. He further said that if he were in my place he would have thought carefully before quitting.
Ans.(c)

Q99. Select the correctly spelt word.
(a) anthropormorphism
(b) anthropomorphisim
(c) anthropomorphism
(d) anthropomorphsm
Ans.(c)

Q100. Spot the correct spelling of an REE-bearing metamorphic texture word.
(a) Prophyroblastic
(b) Porphyroblastic
(c) Porfyrblastic
(d) Porphyroblastik
Ans.(b)